GAUTENG PROVINCE
EDUCATION
REPUBLIC OF SOUTH AFRICA

PARKHURST PRIMARY SCHOOL

"Great oaks from little acorns will grow"

PARKHURST PRIMARY SCHOOL

HOME SCHOOLING RESOURCES PACK COVER PAGE

PERIOD 01/06/2020 - 12/06/2020

GRADE R	GRADE 1	GRADE 2	GRADE 3	GRADE 4	GRADE 5	GRADE 6	GRADE SV
							✓

LEVEL 3

Awesome Learning



Name:_____

Level 3

GRADE	SV Level 3	DATE 1 June	
NAME AND SURNAME			
SUBJECT		English	
TITLE OF WORKSHEET		Listening and speaking Rhyme : Transport	

1. **Learn the following song. Make up your own beat.**

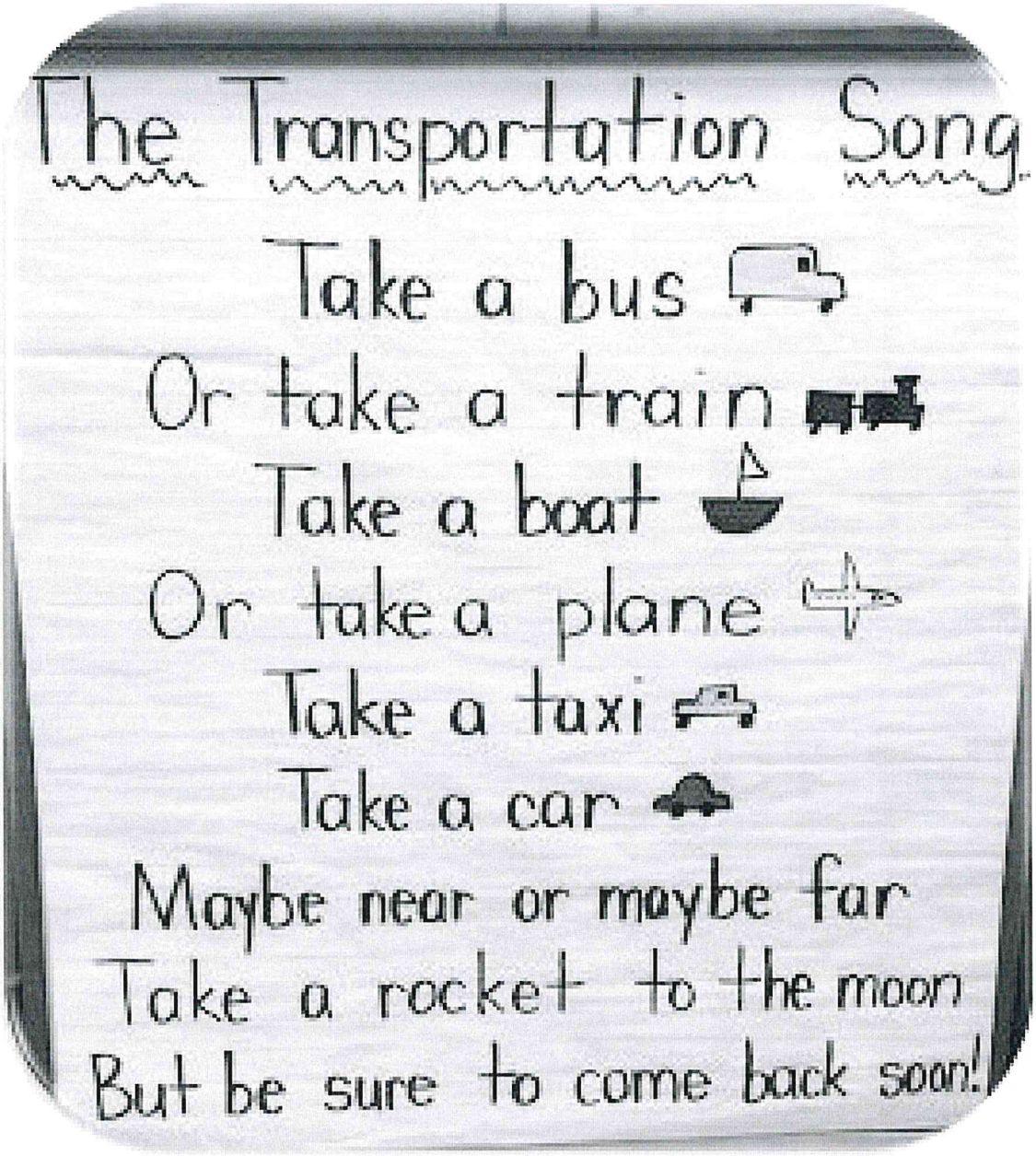

GRADE	SV Level 3	DATE 2 June	
NAME AND SURNAME			
SUBJECT		English	
TITLE OF WORKSHEET		Creative writing	

Write **three** paragraphs about your favourite mode of **transport.** For example air, water or land.

GRADE	SV Level 3	DATE 3 June	
NAME AND SURNAME			
SUBJECT		English	
TITLE OF WORKSHEET		Comprehension	

The Bus Driver

Dana Miller is a bus driver. She drives a bus in the city of Philadelphia.

She works the night shift. That means she starts work at 10:00 at night and gets off at 6:00 in the morning. In the world of bus driving, this is sometimes called third shift.

Dana has been driving a bus for 15 years. She started when she was 23 years old.

She loves her job most of the time. She gets to see the beautiful city from her seat.

She gets to meet all kinds of people.

There is the guitar player. He **lugs** his heavy guitar on the bus every Friday night. He plays at a nightspot downtown.

People call him Get Low. That is because he likes to play the guitar on his knees.

If the bus is not too crowded, Get Low plays in the back of the bus. The bus is seldom crowded at night. He likes to warm up on the bus before shows.

There is the woman who works at the pretzel factory. Each day the "Pretzel Lady" brings Dana a bag of fresh, soft pretzels. They fill the bus with a wonderful smell!

Sometimes Dana's job is hard. It is hard when Dana sees people down on their luck.

One time, a young woman left her sleeping baby on the bus. There was a note on the baby's blanket asking for help. Dana had to call the police.

Another time, a teenaged boy stole money from Dana on the bus. He had a fake gun. Dana thought it was real. She was very scared.

Occasionally, driving the bus can be scary. But most of the time, driving the bus is great. Dana does not want to work anywhere else.
"How was your night?" Dana's husband likes to ask when she gets home.

"Good music, good food and **a great view of the city",** she says.

Questions:

1) Where does Dana drive the bus?

A. around Philadelphia
B. to the police station
C. to pick up guitar players
D. to pick up school children

2) What shift does Dana work?

A. third shift
B. evening shift
C. afternoon shift
D. second shift

3) How old is Dana?

A. 15
B. 23
C. 38
D. 39

4) How long is Dana's shift?

A. 6 hours
B. 8 hours
C. 10 hours
D. 12 hours

5) What is one reason Dana loves her job?

A. She finds sleeping babies.
B. She gets to call the police.
C. She gets to sleep during the day.
D. She gets to meet all kinds of people.

6) Why is the guitar player called Get Low?

A. He has a low voice.
B. He likes to play sitting down.
C. He likes to play on his knees.
D. It is the name of his favorite song.

7) What does **lug** mean?

A. to throw
B. to push easily
C. to carry on one's head
D. to carry something that is hard

8) The main reason Get Low rides the bus is because

A. he likes to see the city
B. he enjoys talking to Dana
C. he likes to play guitar there to move around
D. he needs to get to a show

9) How often does Get Low play guitar on the bus?

I. when the bus is not crowded II. when he doesn't have a show III. every Friday night

A. I only
B. I and II
C. II and III
D. I, II, and III

10) Who gives Dana pretzels?

A. the guitar player
B. the young mom
C. the teenager
D. the woman who works at the factory

Questions:

11) Why might the young woman have left her baby on the bus?

A. She forgot it there.
B. It was sleeping.
C. She meant to come right back.
D. She felt she could not take care of it.

12) Who steals money?

A. Get Low
B. the baby's mother
C. a teenager
D. Dana

13) Why does Dana seem to think people do bad things?

I. They are down on their luck. II. They are bad by nature.
III. They know Dana is vulnerable.

A. I only
B. I and II
C. II and III
D. I, II, and III

14) As used at the end of the story, which is the best synonym for **occasionally**?

A. seldom
B. one time
C. frequently
D. usually

GRADE	SV Level 3	DATE 4 June	
NAME AND SURNAME			
SUBJECT	English		
TITLE OF WORKSHEET	Phonics and Blends : Beginning sounds		

Learn the following spelling words. Write a sentence of each word and draw the picture.

frog	frame
freeze	from
fruit	frown
friends	free
front	Friday

Sentences.

GRADE	SV Level 3	DATE 5 June	
NAME AND SURNAME			
SUBJECT		English	
TITLE OF WORKSHEET		Spelling words	

Spelling Words Week 1	Monday	Tuesday	Wednesday	Thursday
aeroplane				
taxi				
bus				
car				
boat				
bicycle				
train				
helicopter				
tractor				
ambulance				
walking				
pram				
yacht				
ship				
canoe				
submarine				
horse				
donkey				
camel				
truck				

Instructions

5. They need to sound out each word three times and read the words. They must write each word everyday for :(Monday, Tuesday, Wednesday and Thursday).

6. They need to know the meaning of each word and use it in a sentence.

7. They use five words per day to write five sentences for four days. (Write the word, write the sentence).

8. The fifth day they spell all the words, they start with the first ten, if they get it wrong, they need to study and do the spelling test again before they do the last ten words.

Week 2

GRADE	SV Level 3	DATE 8 June	
NAME AND SURNAME			
SUBJECT	English		
TITLE OF WORKSHEET	Spelling		

Spelling Words Week 2	Monday	Tuesday	Wednesday	Thursday
apple				
banana				
pear				
grapes				
orange				
watermelon				
strawberries				
apricot				
avocado				
cherries				
lemon				
mango				
potatoes				
onions				
beans				
cabbage				
carrot				
cauliflower				
cucumber				
mushrooms				

Instuctions

5. They need to sound out each word three times and read the words. They must write each word everyday for :(Monday, Tuesday, Wednesday and Thursday).
6. They need to know the meaning of each word and use it in a sentence.
7. They use five words per day to write five sentences for four days. (Write the word, write the sentence).
8. The fifth day they spell all the words, they start with the first ten, if they get it wrong, they need to study and do the spelling test again before they do the last ten words.

GRADE	SV Level 3	DATE 9 June	
NAME AND SURNAME			
SUBJECT	English		
TITLE OF WORKSHEET	Vegetable song		

Learn the following song

The Vegetable Song

To the tune of Twinkle, Twinkle Little Star

Carrots, peas, and broccoli
Vegetables are good for me,
For my snack and in my lunch,
Veggies sticks are great to munch.
Carrots, peas, and broccoli
Vegetables are good for me!



GRADE	SV Level 3	DATE 10 June	
NAME AND SURNAME			
SUBJECT		English	
TITLE OF WORKSHEET		Creative writing	

Write three paragraphs of five sentences each about your Favourite vegetables. Give reasons why you like them and what their benefits are.

GRADE	SV Level 3	DATE 11 June	
NAME AND SURNAME			
SUBJECT		English	
TITLE OF WORKSHEET		Poem	

Learn the following poem.

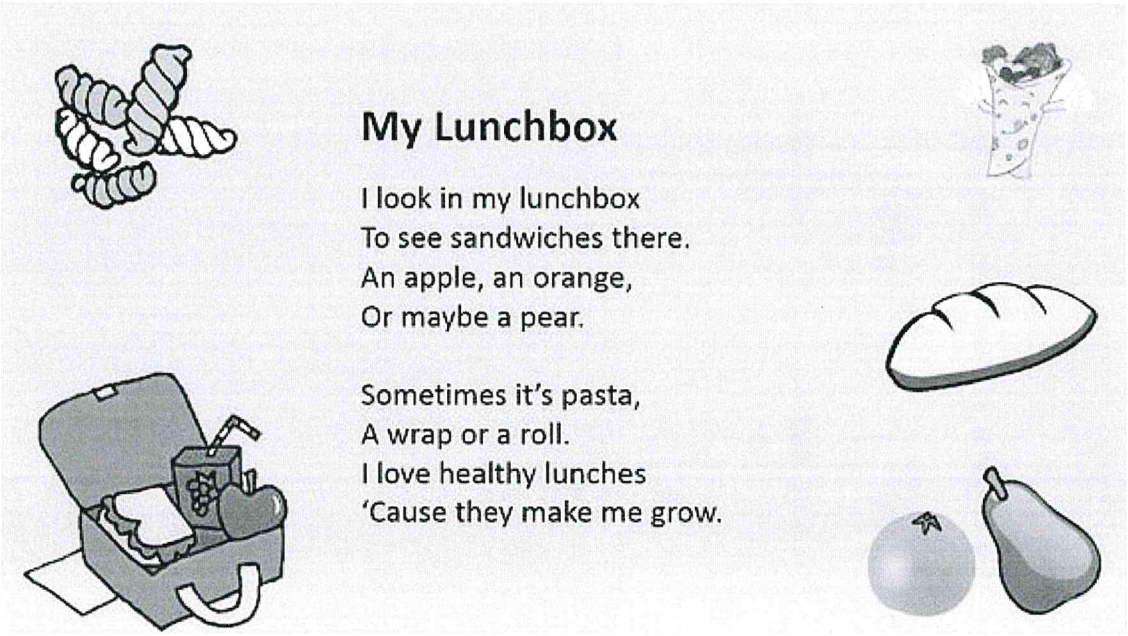

What do we need to stay healthy? Give ten examples.

GRADE	SV Level 3	DATE 12 June	
NAME AND SURNAME			
SUBJECT		English	
TITLE OF WORKSHEET		Project : Poster about transport	

Make a poster about your favourite mode of transport using pictures from a magazine or recycle material.

For example : air, land or water.

Awesome Learning

SV

Level 3

Name:_____

GRADE	SV Level 3	DATE 1 June	
NAME AND SURNAME			
SUBJECT		Maths	
TITLE OF WORKSHEET		Counting	

Complete the sequences

600, 610, _____, _____, _____, _____, 660.

610, 612, _____, _____, _____, _____, _____, _____, _____.

648, 650, _____, _____, _____, _____, 660, _____.

615, 620, 625, _____, _____, 640, _____, _____, _____.

640, _____, _____, 643, _____, _____, _____, 647, _____.

Write the 10 numbers that comes after 700.

700, ____, ____, ____, ____, ____, ____, ____, ____, ____, ____.

722, 724, 726, ___, ____, ____, ____, ____, ____, ____, ____, ____, ___.

745, 750, 755, ___, ____, ____, ____, ____, ____, ____, ____, ___, ____.

740, ____, ____, 743, ____, ____, ____, 747, ____, 749, ____, ____, ___

GRADE	SV Level 3	DATE 2 June	
NAME AND SURNAME			
SUBJECT		Maths	
TITLE OF WORKSHEET		Number names	

Write the number names

332 _____

594 _____

458 _____

527 _____

691 _____

773 _____

985 _____

808 _____

684 _____

770 _____

GRADE	SV Level 3	DATE 3 June	
NAME AND SURNAME			
SUBJECT		Maths	
TITLE OF WORKSHEET		Addition up to 1000	

Calculate

300 + 500 = _____ 324 + 100 = _____

400 + 200 = _____ 235 + 300 = _____

300 + 300 = _____ 245 + 600 = _____

600 + 300 = _____ 346 + 400 = _____

200 + 600 = _____ 499 + 500 = _____

800 + 200 = _____ 372 + 600 = _____

900 + 100 = _____ 264 + 500 = _____

400 + 500 = _____ 696 + 400 = _____

500 + 400 = _____ 539 + 300 = _____

500 + 500 = _____ 426 + 500 = _____

600 + 300 = _____ 206 + 700 = _____

GRADE	SV Level 3	DATE 4 June	
NAME AND SURNAME			
SUBJECT	Maths		
TITLE OF WORKSHEET	Subtraction up to 1000		

Calculate

800 - 300 = _____ 376 - 200 = _____

600 - 200 = _____ 641 - 300 = _____

900 - 500 = _____ 950 - 600 = _____

400 - 300 = _____ 703 - 400 = _____

800 - 300 = _____ 694 - 500 = _____

300 - 100 = _____ 787 - 500 = _____

700 - 600 = _____ 497 - 200 = _____

600 - 400 = _____ 984 - 500 = _____

800 - 600 = _____ 949 - 600 = _____

700 - 200 = _____ 775 - 600 = _____

GRADE	SV Level 3	DATE 5 June	
NAME AND SURNAME			
SUBJECT		Maths	
TITLE OF WORKSHEET		Rounding off to the nearest ten	

Rounding off to the nearest ten. Write down the correct answer. You may use your number chart to help you.

45 = 50 43 = 40 110 = 120 205 = 210 268 = 270

62 = _____ 9 = _____ 21 = _____

37 = _____ 44 = _____ 36 = _____

55 = _____ 58 = _____ 65 = _____

309 = _____ 359 = _____ 343 = _____

346 = _____ 336 = _____ 324 = _____

453 = _____ 329 = _____ 355 = _____

304 = _____ 342 = _____ 416 = _____

537 = _____ 929 = _____ 745 = _____

412 = _____ 532 = _____ 432 = _____

Week 2

GRADE	SV Level 3	DATE 8 June	
NAME AND SURNAME			
SUBJECT	Maths		
TITLE OF WORKSHEET	Greater, Less than		

Write in the symbol that makes the problem true.

$>, <$ or $=$

1. 35 ☐ 52	2. 40 ☐ 74	3. 45 ☐ 30
4. 84 ☐ 77	5. 38 ☐ 64	6. 51 ☐ 39
7. 43 ☐ 43	8. 79 ☐ 28	9. 99 ☐ 89
10. 23 ☐ 22	11. 66 ☐ 77	12. 6 ☐ 16
13. 98 ☐ 89	14. 18 ☐ 18	15. 30 ☐ 49

GRADE	SV Level 3	DATE 9 June	
NAME AND SURNAME			
SUBJECT		Maths	
TITLE OF WORKSHEET		Time	

Time

Answer the following questions.

How many hours in a day? _____ .

How many minutes in an hour? _____ .

How many hours are we at school on a Tuesday and a Thursday?
_____ .

How many hours are we at school on a Monday and a Friday?
_____ .

How many seconds in 1 minute ? _____ .

GRADE	SV Level 3	DATE 10 June	
NAME AND SURNAME			
SUBJECT		Maths	
TITLE OF WORKSHEET		Division	

Division

Lets divide by 5.

15 ÷ 5 = 3

Count in 5s until you reach 15

5 + 5 + 5

How many 5s can you count?

There are 3 fives in 15

Now you try!

20 ÷ 5 = _____ 10 ÷ 5 = _____

40 ÷ 5 = _____ 35 ÷ 5 = _____

25 ÷ 5 = _____ 30 ÷ 5 = _____

GRADE	SV Level 3	DATE 11 June	
NAME AND SURNAME			
SUBJECT	Maths		
TITLE OF WORKSHEET	Arrange the numbers from big to small, small to big. Data Handling		

Arrange the numbers from big to small

156, 218, 263, 148, 292

Arrange the numbers from small to big

159, 382, 264, 174, 148

© Die Leer Hoekie

GRADE	SV Level 3	DATE 12 June	
NAME AND SURNAME			
SUBJECT	Maths		
TITLE OF WORKSHEET	Data Handling		

Make a pictograph using the blocks below.
Use this data:

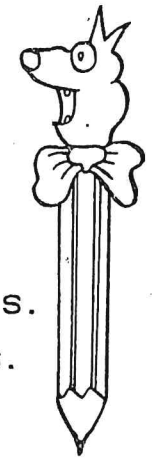

- On Monday the Tuckshop sold 12 muffins.
- On Tuesday the Tuckshop sold 8 muffins.
- On Wednesday the Tuckshop sold 6 muffins.
- On Thursday the Tuckshop sold 10 muffins.
- On Friday the Tuckshop sold 13 muffins.

Monday	Tuesday	Wednesday	Thursday	Friday

Answer the following questions about the pictograph

1. How many muffins were sold in the week? _____.

2. On which day were the most muffins sold? _____.

3. On which day were the least muffins sold? _____.

4. What is the difference between the muffins sold on Tuesday and Wednesday? _____